Curves and Corners Lab

Write each shape letter in one box. Look carefully at its edge.

Name: _____



A



B

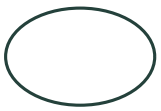

C



D



E



F

Only straight sides

_____

Only curved edge

_____

Straight and curved edge

_____

Curves and Corners Lab

For a grown-up. Invite the child to explain or point to an answer.

- Only straight sides: B, D, F.
- Only curved edge: A, C.
- Straight and curved edge: E.

Try it together

A semicircle has one straight side and one curved edge. A circle has no corners.

An adult may read the words aloud. Drawn, spoken and pointed answers are welcome.